Student K-A



Student K-B

Name_____

Jo made two trays of cookies. One tray had 6 cookies on it. Together, both trays had 10 cookies. How many cookies were on the second tray?

Use pictures, numbers, and words to show how you found the answer.



Student K-C

6+4=10

1	2	3	4	5
6 +	1	2	3	4

= 10

4 moves.

Sudent K-D



I hav 10 cuce's.
I put 6 on a plato
I put 4 on a plato